Geometria

Inserisci i dati nello schizzo e costruisci la figura.

1. **Quadrato**

   lato $a = 8$ cm
   (altezza $h = 3$ cm)
   angolo $\alpha = 45°$
   angolo $\beta = 60°$

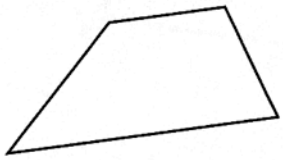

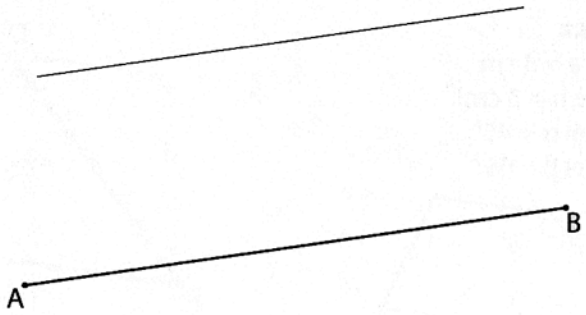

2. **Trapezio**

   lato $a = 8$ cm
   lato $b = 5$ cm
   (altezza $h = 4$ cm)
   angolo $\delta = 125°$

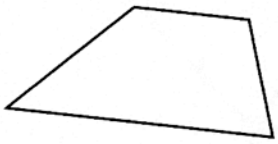

3. **Trapezio**

   lato $c = 9$ cm
   lato $b = 4$ cm
   mediana $m = 6$ cm
   (altezza $h = 3$ cm)

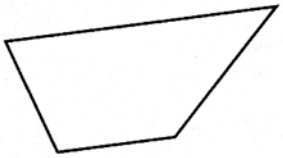



4. **Rombo**
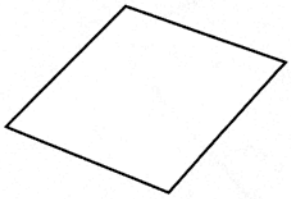
   lato $a = 5$ cm
   lunghezza diagonale $AC = 8$ cm