Matematica Livello secondario I

Preparazione agli esami di ammissione (serie)	Nome e cognome	Punti	Nota
SOLIDI FORMATI DA CUBI Z18	Data		

A destra vedi le tre proiezioni del solido, composta da 6 cubi. Disegna il solido (unità due quadretti)

1 da sopra frontale da destra

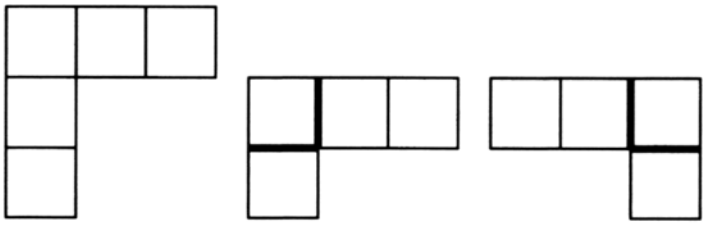

2. da sopra frontale da destra

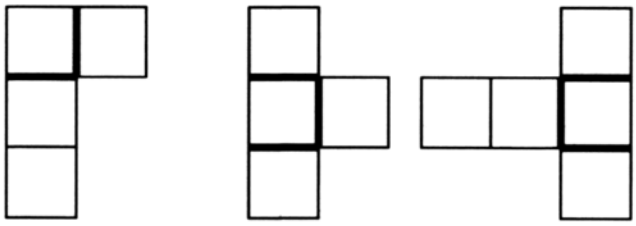

3. da sopra frontale da destra

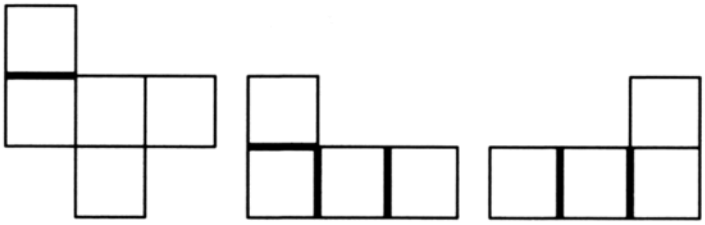
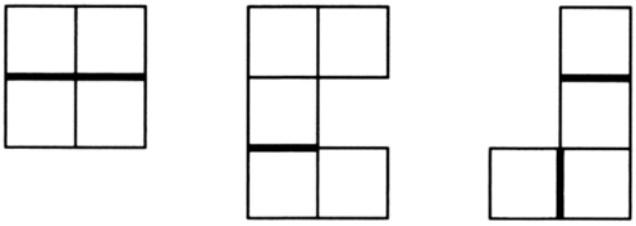
4. da sopra frontale da destra